Unit 2 Evaluation

Name: _____ Class: _____ Date: _____

Mark the correct answers with a ✔.

Look at the image and answer questions 1–3.



1 What are structures c and d?

A. Stem and roots.

B. Flower and leaves.

2 Which part is responsible for absorbing water?

A. b.

B. d.

3 Which part keeps the plant vertical?

A. c.

B. d.

D.R. © Richmond Publishing, S.A. de C.V., 2014

4 What happens when a plant loses its leaves?

A. The plant cannot absorb water.

B. The plant cannot make its own food.

5 In what part of a plant do seeds form?

A. The fruit.

B. The stem.

6 Which of these is a type of seed?

A. Lentils

B. Apple

7 Which do you need to give a plant at home?

A. Water.

B. Food.

8 What characteristic of plants is it when a sunflower follows the sun during the day?

A. The ability to reproduce.

B. The ability to respond to stimuli.

9 What characteristic of living things do plants and animals share?

A. The ability to reproduce.

B. The ability to move around.

D.R. © Richmond Publishing, S.A. de C.V., 2014

Study the experiment and answer questions 10 and 11.



10 In which direction will the plant grow?

A. Toward a.

B. Toward b.

11 If the light were on the other side, in which direction would the plant grow?

A. Toward a.

B. Toward b.

12 Martina kept a plant in a box, where it did not receive any light. Martina watered the plant every day, but it died. Why did the plant die?

A. It needed more water.

B. It needed light.

D.R. © Richmond Publishing, S.A. de C.V., 2014

Look at the images and answer questions 13–15.



13 What type of plant is the plant in group 1?

A. A bush

B. A grass.

14 What group is this plant part of?

A. Group 1.

B. Group 2.

15 In which group is a plant with branches that grow close to the ground?

A. Group 1.

B. Group 2.

D.R. © Richmond Publishing, S.A. de C.V., 2014

16 How are the fruits different?

Nut

Pear



A. The nut is a fleshy fruit, and the pear is a dry fruit.

B. The nut is a dry fruit, and the pear is a fleshy fruit.

17 Which of these is a fruit?

A. Almonds

B. Sunflower seeds

18 How would you classify the fruit in question 17?

A. Fleshy.

B. Dry.

D.R. © Richmond Publishing, S.A. de C.V., 2014

19 Which of these plants has a soft, smooth, green stem?

A.

B.

20 Which of these is a tree?

A. Wheat.

B. Oak.

21 Manuel and his family are camping in a national park. They make a campfire to cook some food. What should they do to protect the plant life?

D.R. © Richmond Publishing, S.A. de C.V., 2014

Unit 2 Evaluation

Name: _____ Class: _____ Date: _____

Mark the correct answers with a ✔.

Look at the following image and answer questions 1–3.



1 What are structures a and b?

A. Stem and roots.

B. Flower and leaves.

2 Which part is responsible for absorbing water?

A. c.

B. d.

3 Which structure keeps the plant vertical?

A. c.

B. d.

D.R. © Richmond Publishing, S.A. de C.V., 2014

4 What happens to a plant if it loses its roots?

A. The plant cannot absorb water.

B. The plant cannot make its own food.

5 What part of a plant does the fruit develop from?

A. Leaves.

B. Flower.

6 Which of these is a fruit?

A. Lentils

B. Apple

7 What do all plants need to live?

A. Sunlight.

B. Fruit.

8 What characteristic of living things is it when a flower opens in the sunlight?

A. The ability to respond to stimuli.

B. The ability to reproduce.

D.R. © Richmond Publishing, S.A. de C.V., 2014

9 What characteristic is it when a plant measures 5 centimeters one month and 12 centimeters the next month?

A. Reaction to stimuli.

B. Growth.

Study the experiment and answer questions 10 and 11.

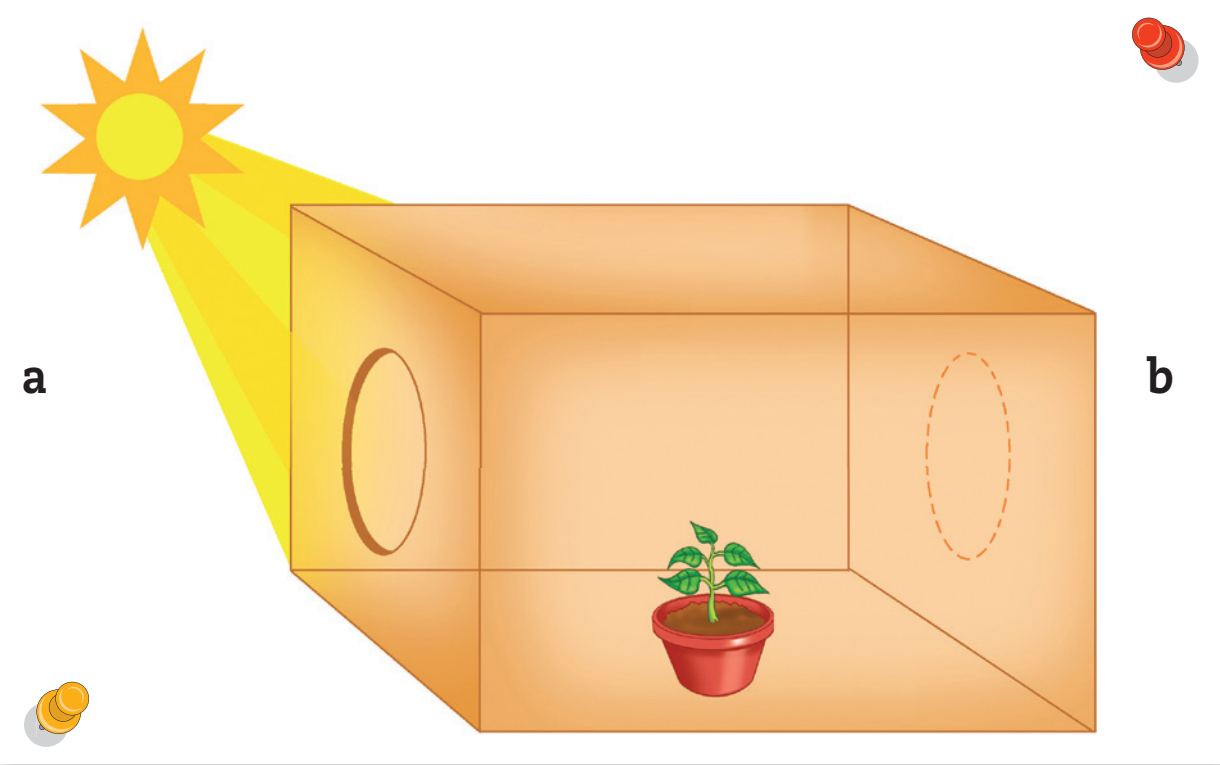

10 In which direction will the plant grow?

A. Toward a.

B. Toward b.

11 If the light were on the other side, in which direction would the plant grow?

A. Toward a.

B. Toward b.

D.R. © Richmond Publishing, S.A. de C.V., 2014

12 Martina put her favorite plant where it received a lot of light. She watered the plant rarely, and it died. Why did the plant die?

A. It needed more water.

B. It needed more light.

Look at the images and answer questions 13–15.

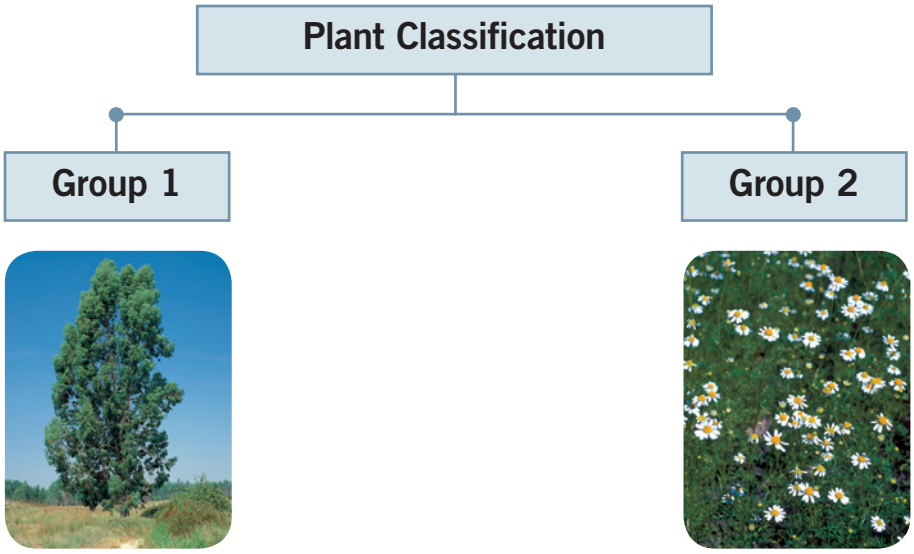

13 What type of plant is the plant in group 1?

A. Tree.

B. Grass.

14 In which group is this plant?

A. Group 1.

B. Group 2.

D.R. © Richmond Publishing, S.A. de C.V., 2014

15 In which group is the grass in a park?

A. Group 1.

B. Group 2.

16 How are the fruits different?

Hazelnut

Apple

A. The hazelnut is a dry fruit, and the apple is a fleshy fruit.

B. The hazelnut is a fleshy fruit, and the apple is a dry fruit.

17 Which of these is a fruit?

A. Almonds

B. Sunflower seeds

18 How would you classify the fruit in question 17?

A. Fleshy.

B. Dry.

D.R. © Richmond Publishing, S.A. de C.V., 2014

19 Which of these plants has a hard, rough, brown stem?

A.

B.

20 Which of these is a type of grass?

A. Pine.

B. Wheat.

21 Mary observes that some woodcutters have cut down part of a forest. What can Mary do to protect the forest where the trees were cut down?

D.R. © Richmond Publishing, S.A. de C.V., 2014